Answers

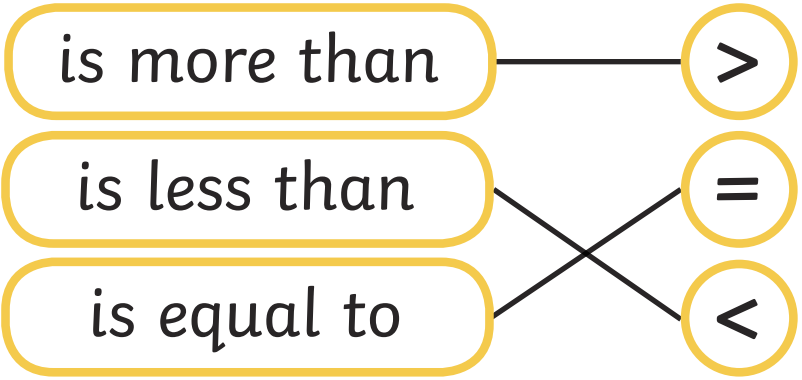
is more than
is less than
is equal to
>
=
<

34	>	33
44	=	44
35	<	40
24	>	22

43	>	4 tens and 0, 1 or 2 ones
Circle drawn around ✓ 28, 29, 30, 31 or 32	<	33
✓ 29	=	2 tens and 9 ones ✓

Jude is not right. He has counted all the objects as ones, but there are 3 tens.

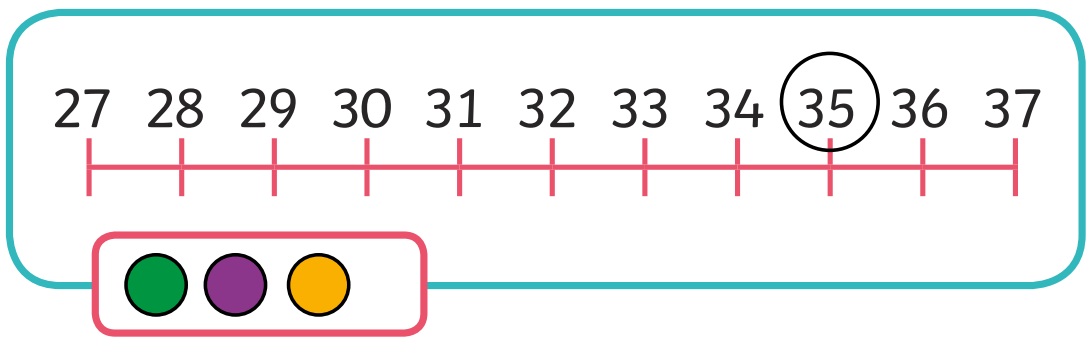
27
28
29
30
31
32
33
34
35
36
37
🟢 🟣 🟠





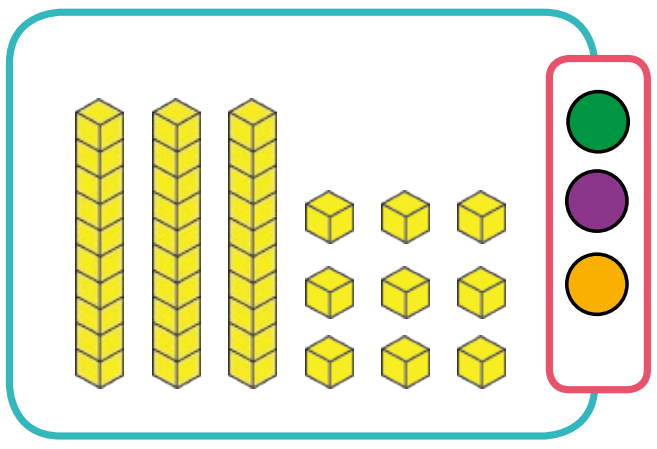

Draw coloured dots to show how many:

- 🔴 less than 30
- 🔵 greater than 41
- 🟢 < 45
- 🟣 >32
- 🟠 greater than 30 but less than 40

🟢 🟣

Draw objects here which would have a green and a purple dot.

The number of objects drawn should be between 33 and 44 (inclusive).



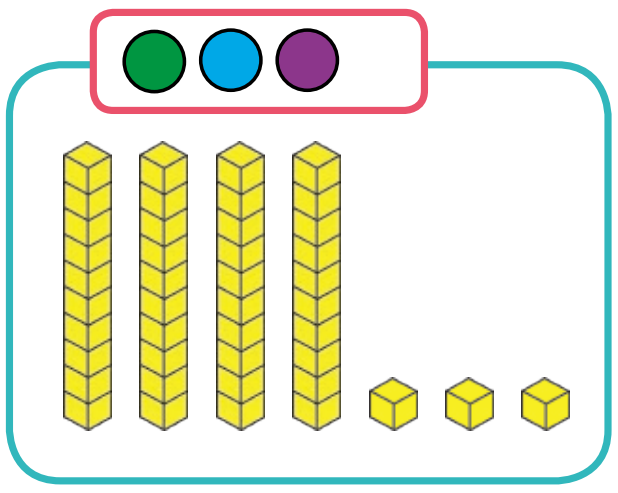

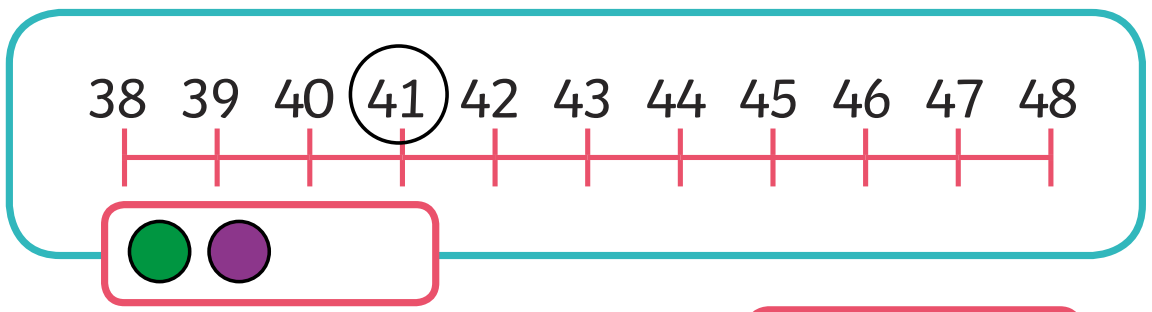
38
39
40
41
42
43
44
45
46
47
48
🟢 🟣

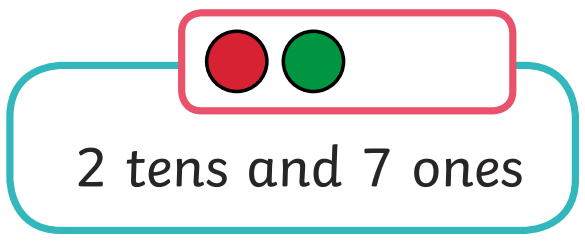
🔴 🟢
2 tens and 7 ones

twinkl
visit twinkl.com
twinkl Quality Standard Approved